Daily Spiral Review 13

MA 2

Name _____ Class _____ Date _____

1. Adding 2-Digit Numbers

Add the **numbers**. Write the answer.

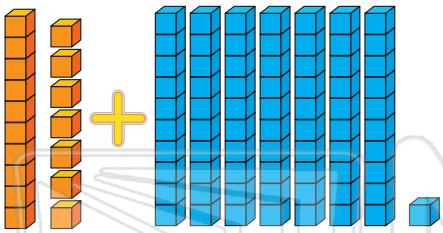

$$\begin{array}{r} 17 \\ +\ 71 \\ \hline \end{array}$$

2. Subtracting 2-Digit Numbers

Which **subtraction sentence** matches the picture?

a. 25 - 5 = 15
b. 20 - 5 = 15
c. 20 - 4 = 16

3. Hundred Counting Chart

Write the **missing** numbers.

73 ◯ 75 ◯ 77

4. Place Value

How would you write a number with **2 hundreds, 8 tens** and **5 ones**?

Complete the chart.

hundreds | tens | ones

PREVIEW

Please Sign In or Sign Up to download the printable version of this worksheet

5.

7.

_____ inches

c. 16

Math	𝍸 𝍸 /
Reading	𝍸 𝍸 ////

9. Ordinal Numbers

Write the **next** ordinal number.

thirteenth

fourteenth

_____

10. Symmetry

Circle shapes with only **one** line of symmetry.



© Copyright NewPath Learning. All Rights Reserved. Permission is granted for the purchaser to make copies for non-commercial educational purposes only. Visit us at www.newpathworksheets.com

Daily Spiral Review 13 - Answer Key

MA 2

Name _____ Class _____ Date _____

1. Adding 2-Digit Numbers

Add the **numbers**. Write the answer.

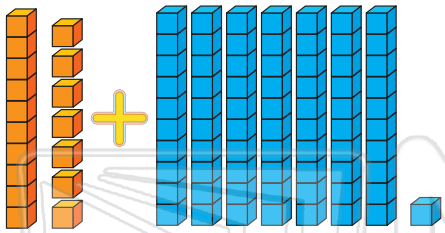

```
  17
+ 71
----
  35
```

2. Subtracting 2-Digit Numbers

Which **subtraction sentence** matches the picture?

a. 25 - 5 = 15
b. 20 - 5 = 15
c. 20 - 4 = 16

3. Hundred Counting Chart

Write the missing numbers.

73 74 75 76 77

4. Place Value

How would you write a number with **2 hundreds**, **8 tens** and **5 ones**?

Complete the chart.

PREVIEW

Please Sign In or Sign Up to download the printable version of this worksheet

5.

H
F

7.

H

5 inches

c. 16

Math	𝍸𝍸 𝍸𝍸 I
Reading	𝍸𝍸 𝍸𝍸 IIII

9. Ordinal Numbers

Write the **next** ordinal number.

thirteenth

fourteenth

fifthteenth

10. Symmetry

Circle shapes with only **one** line of symmetry.

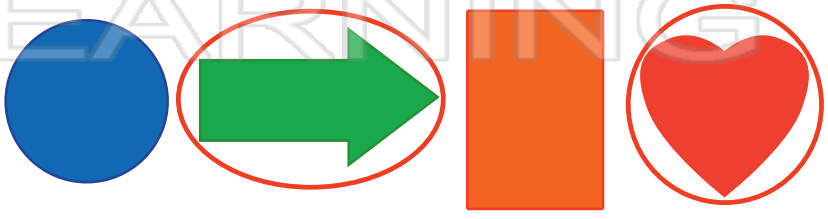

© Copyright NewPath Learning. All Rights Reserved. Permission is granted for the purchaser to make copies for non-commercial educational purposes only. Visit us at www.newpathworksheets.com